Sumas con diez marcos

Cuenta los puntos rojos y los azules, y completa la suma

Nombre: _____ Fecha: _____

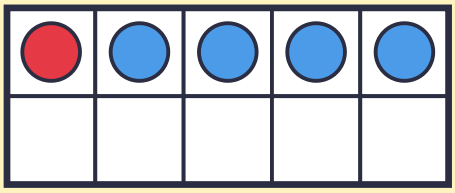

☐ + ☐ = ☐

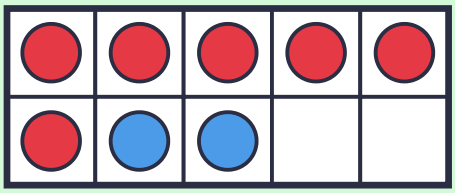

☐ + ☐ = ☐

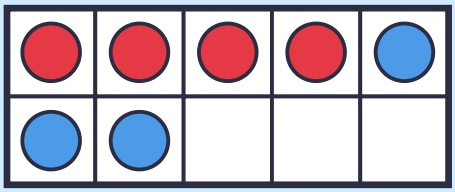

☐ + ☐ = ☐

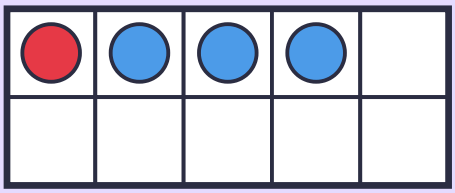

☐ + ☐ = ☐

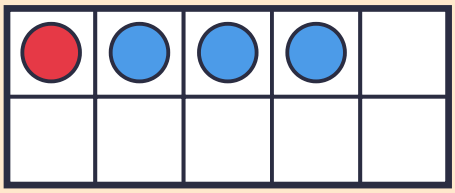

☐ + ☐ = ☐

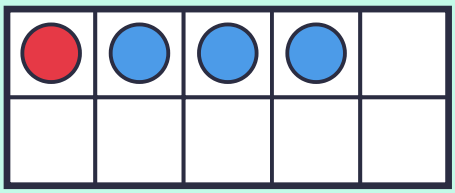

☐ + ☐ = ☐