Números y cantidades del 1 al 10

Une cada número con su grupo de dibujos · cada pareja encaja sola

1

uno



2

dos



3

tres



4

cuatro



5

cinco

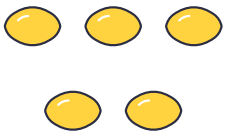

6

seis



7

siete

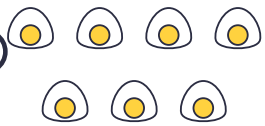

8

ocho



9

nueve



10

diez

