Colorea la fracción

Pinta las partes que indica cada fracción

Nombre: _____ Fecha: _____

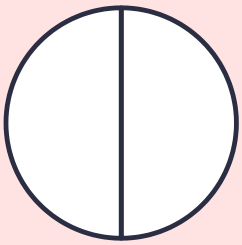

$\frac{1}{2}$



$\frac{3}{4}$

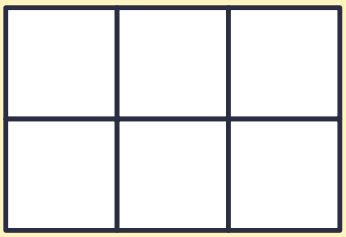

$\frac{5}{6}$



$\frac{1}{4}$

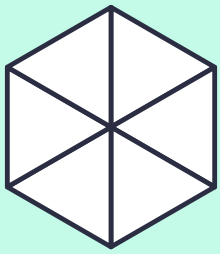

$\frac{4}{6}$



$\frac{2}{3}$



$\frac{3}{5}$



$\frac{3}{8}$



$\frac{5}{8}$

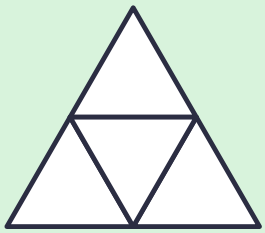

$\frac{3}{4}$



$\frac{7}{10}$

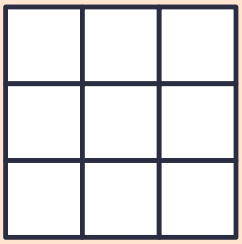

$\frac{4}{9}$