Fracciones mixtas e impropias

Escribe cada cantidad como fracción impropia y como número mixto

Nombre: _____ Fecha: _____

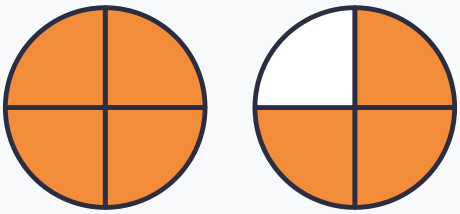

$\frac{7}{4} = 1\frac{3}{4}$

7 cuartos son
1 entero y
3 cuartos



Impropia $\frac{\square}{\square}$ **Mixta** $\square\frac{\square}{\square}$

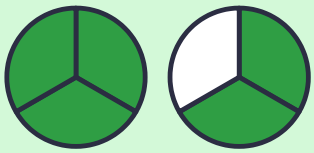

Impropia $\frac{\square}{\square}$ **Mixta** $\square\frac{\square}{\square}$



Impropia $\frac{\square}{\square}$ **Mixta** $\square\frac{\square}{\square}$

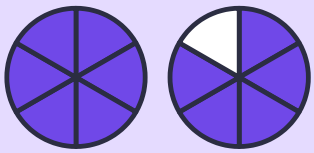

Impropia $\frac{\square}{\square}$ **Mixta** $\square\frac{\square}{\square}$

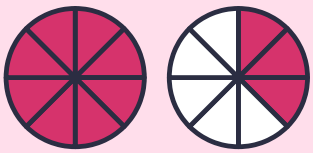

Impropia $\frac{\square}{\square}$ **Mixta** $\square\frac{\square}{\square}$



Impropia $\frac{\square}{\square}$ **Mixta** $\square\frac{\square}{\square}$