Dominó de fracciones

Recorta las fichas y une cada fracción con su dibujo

$\frac{1}{2}$	
$\frac{1}{3}$	
$\frac{2}{3}$	
$\frac{1}{4}$	
$\frac{3}{4}$	
$\frac{2}{5}$	
$\frac{1}{6}$	
$\frac{5}{6}$	
$\frac{3}{8}$	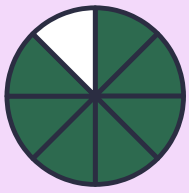
$\frac{7}{8}$	
$\frac{3}{10}$	
$\frac{4}{9}$	