Memorama de fracciones

Recorta las 24 tarjetas y forma parejas de dibujo y fracción



$\frac{1}{6}$

$\frac{3}{10}$

$\frac{1}{4}$



$\frac{2}{3}$

$\frac{4}{9}$

$\frac{7}{8}$



$\frac{5}{6}$

$\frac{1}{3}$

$\frac{3}{4}$











$\frac{2}{5}$





$\frac{3}{8}$

$\frac{1}{2}$



