# Cuerpos geométricos

Observa cada cuerpo y escribe cuántas caras, aristas y vértices tiene

## Cubo

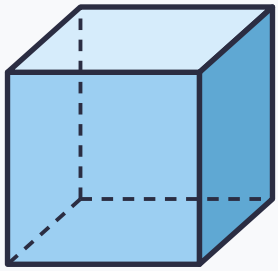

Caras: ☐

Aristas: ☐

Vértices: ☐

## Prisma

rectangular

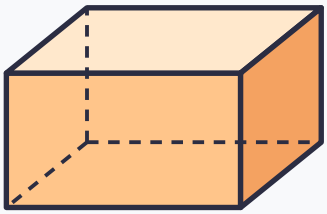

Caras: ☐

Aristas: ☐

Vértices: ☐

## Cilindro



Caras: ☐

Aristas: ☐

Vértices: ☐

## Cono

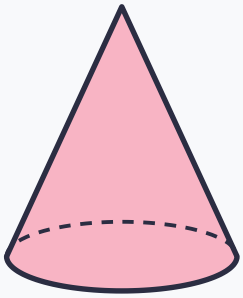

Caras: ☐

Aristas: ☐

Vértices: ☐

## Esfera

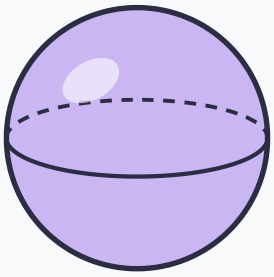

Caras: ☐

Aristas: ☐

Vértices: ☐

## Pirámide

cuadrangular

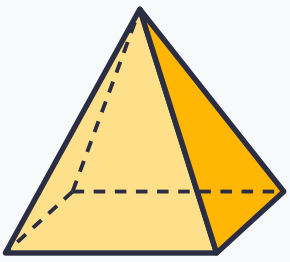

Caras: ☐

Aristas: ☐

Vértices: ☐